Schattenspiel

Ausgerüstet mit einem Kompass sucht die Maus nach dem richtigen Weg. Welcher Schatten ist der richtige? Vergleiche!







A



B



C



D



E